Dividing with a Numberline

Name:

Use the numberline to solve each problem.

1) 8÷2=

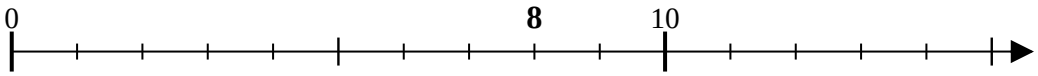

2) 15÷3=

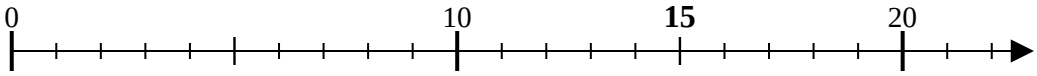

3) 40÷10=

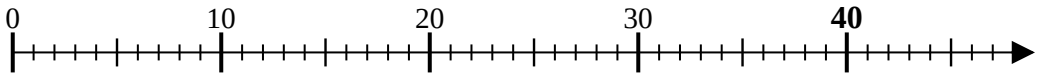

4) 30÷10=

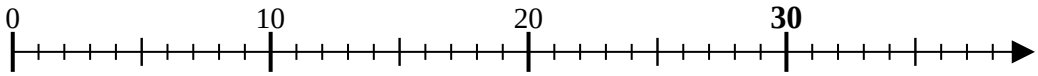

5) 18÷6=

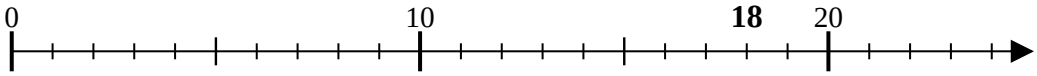

6) 20÷10=

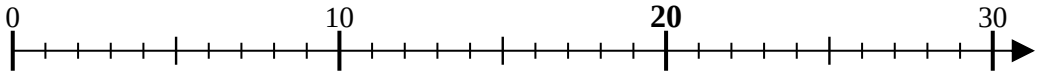

7) 18÷9=

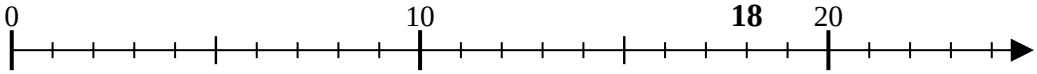

8) 9÷3=

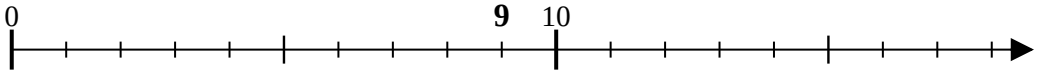

9) 35÷7=

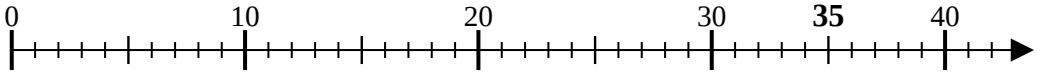

10) 24÷6=

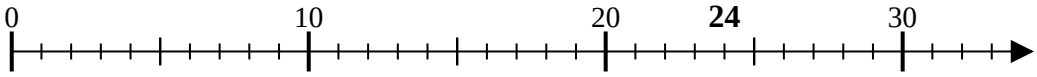

11) 12÷6=

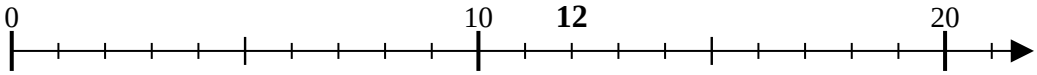

Answers

1. _____
2. _____
3. _____
4. _____
5. _____
6. _____
7. _____
8. _____
9. _____
10. _____
11. _____

1-10	91	82	73	64	55	45	36	27	18	9
11	0									

Dividing with a Numberline

Name: **Answer Key**

Use the numberline to solve each problem.

1) 8÷2=

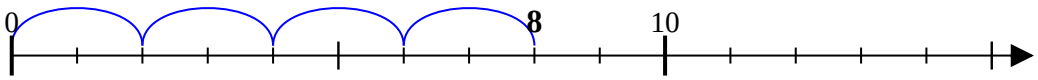

2) 15÷3=

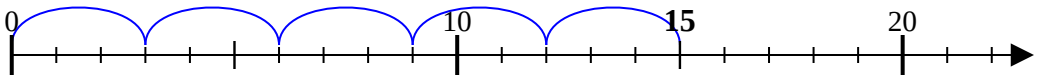

3) 40÷10=

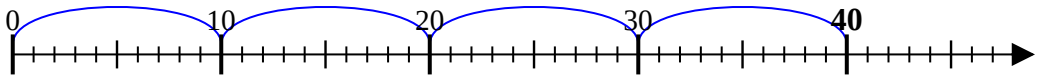

4) 30÷10=

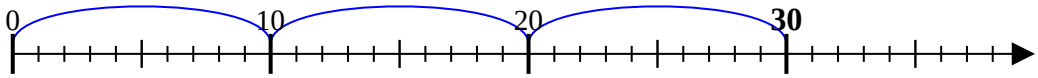

5) 18÷6=

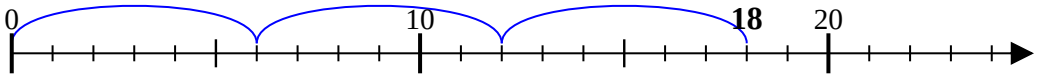

6) 20÷10=

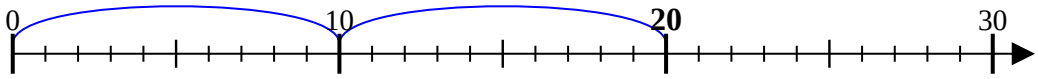

7) 18÷9=

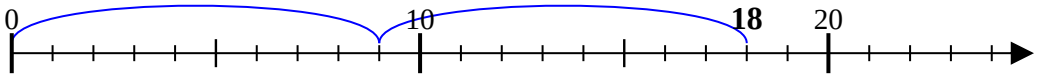

8) 9÷3=

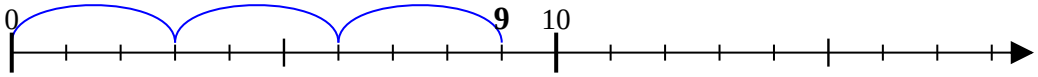

9) 35÷7=

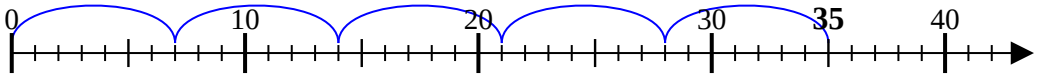

10) 24÷6=

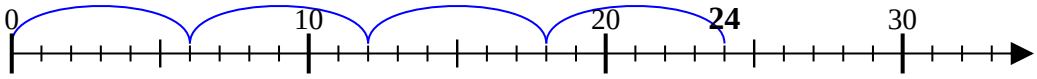

11) 12÷6=

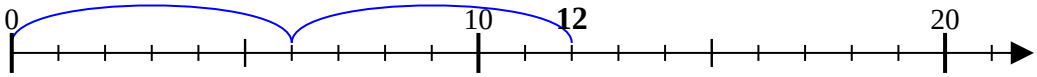

Answers

1. 4
2. 5
3. 4
4. 3
5. 3
6. 2
7. 2
8. 3
9. 5
10. 4
11. 2

1-10	91	82	73	64	55	45	36	27	18	9
11	0									